Kindy Maths with Miss K and Coco

Comparing Numbers to 10

K Maths 1.18

We are learning

To compare two numbers to say which is bigger and which is smaller.

Colour a star when you can do it!



I can say which number is bigger, to 10.



I can say which number is smaller, to 10.



I can use counters or a number line to check, to 10.

Key words

Grown-ups: try this at home

Kindy Maths with Miss K and Coco

Your turn!

K Maths 1.18

Watch the video, then answer these questions.

Question 1



Which number is bigger, two or six?

My answer: ____

Question 2



Which number is smaller, ten or seven?

My answer: ____

Question 3



Which number is smaller, four or nine?

My answer: ____

Question 4

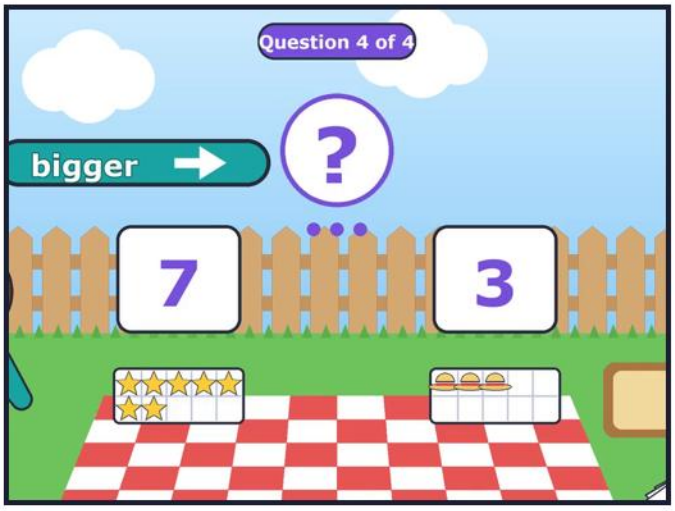

Which number is bigger, seven or three?

My answer: ____

For grown-ups

Answers

1. Six is bigger than two!
2. Seven is smaller than ten!
3. Four is smaller than nine!
4. Seven is bigger than three!

Cut out this ten frame and fill it with small toys, pasta or buttons.

